Exercices CM2

Correction

Tracer des quadrilatères

❶ Trace les quadrilatères demandés

Carré de 3 cm de côté	Rectangle L = 5 cm l = 2 m	Losange de 3 cm de côté
		
Carré dont les diagonales mesurent 4 cm	**Rectangle dont les diagonales mesurent 4 cm**	**Losange dont les diagonales mesurent 4 cm et 2 cm**
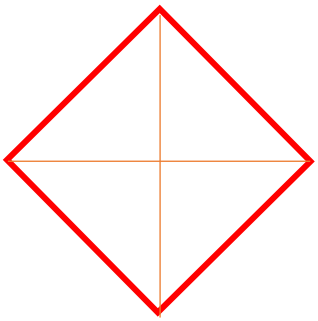	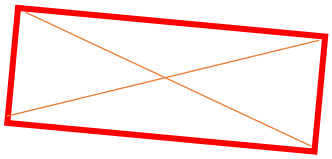	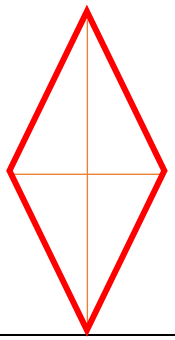

❷ Termine de tracer les quadrilatères dont certains côtés ont déjà été tracés.

Carré	Rectangle	Losange
	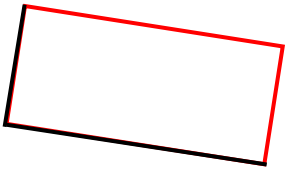	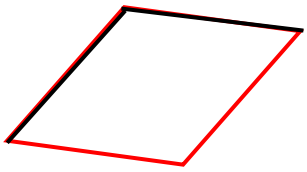

❸ Termine de tracer les quadrilatères dont une diagonale a déjà été tracée.
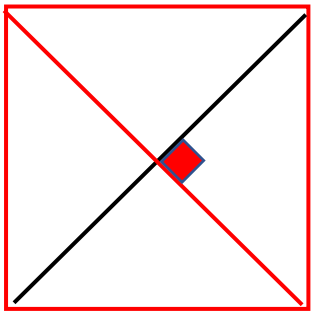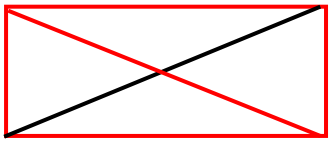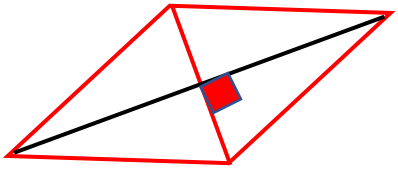
Carré	Rectangle	Losange